All rights reserved. No part of this publication may be reproduced, distributed, or transmitted in any form or by any means, electronic, mechanical, photocopying, recording or otherwise, or stored in any retrieval system of any nature without the permission of cracku.in, application for which shall be made to support@cracku.in

Downloaded from cracku.in

SSC CHSL 19th April 2021 Shift-1

English Language

1. **Select the INCORRECTLY spelt word.**

A Saspence

B Suppress

C Suspicion

D Secrecy

Answer: A

2. **Sentences of a paragraph are given below in jumbled order. Arrange the sentences in the right order to form a meaningful and coherent paragraph.**
   A. The other aspect touches upon certain issues that have arisen in recent years, such as brain-death, mercy killing and cloning.
   B. There are two major aspects relating to the medical profession and its practice the world over.
   C. These issues must be discussed and debated in the public domain in terms of our cultures and value systems.
   D. One of these is the ethics of medical practitioners in their day-to-day relationship with their patients and with one another.

A BCAD

B DABC

C BDAC

D CDAB

Answer: C

3. **Select the option that expresses the given sentence in the active or passive voice.**
   Celebrate the New Year with amazing offers.

A The New Year should be celebrated with amazing offers.

B The New Year will be celebrated with amazing offers.

C Amazing offers will be celebrate in the New Year.

D Let the New Year be celebrated with amazing offers.

Answer: D

4. **Select the INCORRECTLY spelt word.**

A Adamant

B Acheivmant

C Eligibility

D Relevant

Answer: B

Downloaded from cracku.in

5. **The following sentence has been split into four segments. Identify the segment that contains a grammatical error.**
Public speaking / is one of / the most feared form / of communication.

A the most feared form

B is one of

C Public speaking

D of communication

Answer: A

6. **Select the option that expresses the given sentence in reported speech.**
He said to his sister, "Please help me with my homework."

A His sister told him that he should help her with her homework.

B He requested his sister to help him with his homework.

C His sister was asked by her brother that she should help him with his homework.

D He told his sister that she should help him with his homework.

Answer: B

7. **Select the most appropriate synonym of the given word.**
Mandatory

A Imperative

B Impervious

C Optional

D Unnecessary

Answer: A

SSC CHSL Prevoius Papers (DOWNLOAD PDF)

8. **Select the most appropriate synonym of the given word.**
Abode

A Habituation

B Aboard

C Dwelling

D Annex

Answer: C

9. **Select the most appropriate meaning of the given idiom.**
To drag one's feet

Downloaded from cracku.in

A To walk unsteadily

B To walk with a limp

C To pull someone's legs

D To delay taking a decision

Answer: D

10. **Select the most appropriate option to substitute the underlined segment in the given sentence. If there is no need to substitute it, select 'No substitution required'.**
Fermented vegetables can be stored for about a year <u>without going bad</u>.

A without going worst

B with going bad

C No substitution required

D to go bad

Answer: C

SSC CGL Previous Papers (DOWNLOAD PDF)

11. **Select the most appropriate word to fill in the blank.**
We admit students with _____ academic backgrounds like life sciences, physical sciences, and business and commerce.

A diverse

B similar

C simple

D same

Answer: A

12. **Select the most appropriate ANTONYM of the given word.**
Malicious

A Culpable

B Decent

C Perverted

D Biased

Answer: B

13. **The following sentence has been split into four segments. Identify the segment that contains a grammatical error.**
After a long gap, / we went shopping / last Sunday and bought / that we wanted.

A we went shopping

B After a long gap

Downloaded from cracku.in

C that we wanted

D last Sunday and bought

Answer: C

SSC CGL Free Mock Test (Latest Pattern)

14. **Select the most appropriate word to fill in the blank.**
Please complete the short questionnaire _____ and return it to us.

A separated

B attached

C excluded

D concluded

Answer: B

15. **Select the most appropriate option to substitute the underlined segment in the given sentence. If there is no need to substitute it, select 'No substitution required'.**
I cannot help you <u>if you tell me</u> your problem.

A No substitution required

B unless you don't tell me

C until you don't tell me

D unless you tell me

Answer: D

16. **Select the option that can be used as a one-word substitute for the given group of words.**
Withdraw from a forward position in battle

A Retreat

B Resort

C Restore

D Relocate

Answer: A

SSC CHSL Important Questions and Answers (Download PDF)

17. **Select the most appropriate meaning of the given idiom.**
To make both ends meet

A To have just enough money to live

B To try to do two different things at the same time

C To try to bring two parties together

Downloaded from cracku.in

D To try to solve a problem between friends

Answer: A

18. **Select the option that can be used as a one-word substitute for the given group of words.**
Relating to the present time

A Corollary

B Ancient

C Preceding

D Contemporary

Answer: D

19. **Sentences of a paragraph are given below in jumbled order. Arrange the sentences in the right order to form a meaningful and coherent paragraph.**
A. But he has reached out to millions of people the world over and helped to improve their lives.
B. Born in downtown Los Angeles in 1960, Tony Robins came from very humble beginnings.
C. Now he travels by private jet and owns properties in many parts of the world.
D. His family had been fed by others when they did not have enough money for food.

A BDCA

B ADBC

C DABC

D CABD

Answer: A

SSC CHSL Study Material

20. **Select the most appropriate ANTONYM of the given word.**
Resign

A Accept

B Reject

C Join

D Sign

Answer: C

Instructions [21 - 25]

In the following passage, some words have been deleted. Select the most appropriate option to fill in each blank.

Comprehension:
All of us know that the American astronaut Neil Armstrong was the first (1) _____ to set foot on the Moon in July 1969. Human footprints on the lunar (2) _____ won't disappear for millions of years. That is because there is no rain or wind to (3) _____ them. The surface area of the Moon is 25% larger than that of Africa. Astronauts have so far brought back hundreds of kilos of rock and dust from the Moon to (4) _____. It takes the Moon 27.3 days to travel around the Earth. As it does so, we see different amounts of its side (5) _____ by the Sun.
That is why it appears to get larger and then smaller.

21. **Select the most appropriate option to fill in blank number 1.**

Downloaded from cracku.in

A creature

B object

C human

D organisms

Answer: C

22. **Select the most appropriate option to fill in blank number 2.**

A surface

B dust

C eclipse

D rock

Answer: A

SSC CHSL Free App

23. **Select the most appropriate option to fill in blank number 3.**

A restore

B recreate

C replicate

D erode

Answer: D

24. **Select the most appropriate option to fill in blank number 4 .**

A store

B sell

C study

D show

Answer: C

25. **Select the most appropriate option to fill in blank number 5.**

A heated

B covered

C hidden

D lit

Answer: D

Downloaded from cracku.in

Daily Free SSC Practice Set

General Intelligence

26. **Select the option in which the given figure is embedded (rotation is NOT allowed).**

A 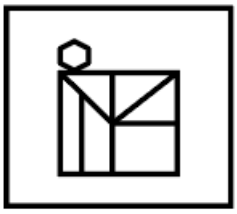

B 

C 

D 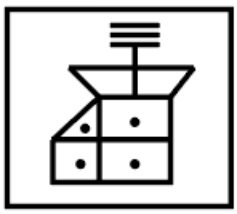

Answer: B

Free SSC Study Material (18,000 Solved Questions)

27. **Four number-pairs have been given, out of which three are alike in some manner and one is different. Select the one that is different.**

A 11 : 122

B 14 : 112

C 21 : 168

D 18 : 144

Answer: A

Downloaded from cracku.in

28. **Select the correct mirror image of the given combination when the mirror is placed at 'PQ' as shown.**

A 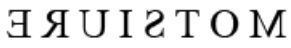

B 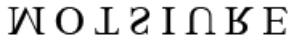

C 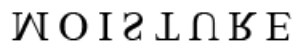

D 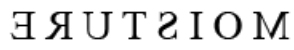

Answer: D

29. **Select the figure that will replace the question mark (?) in the following figure series.**

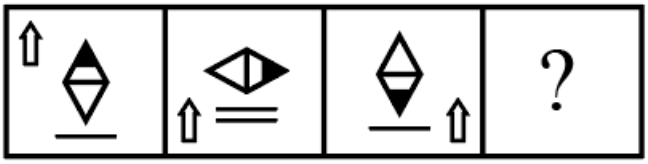

A 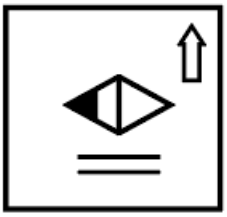

B

C 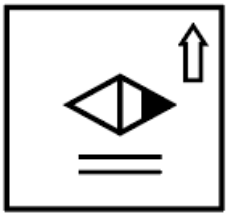

D 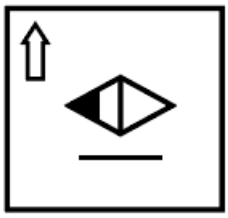

Answer: A

1500+ Very Important Free SSC Solved Questions

Downloaded from cracku.in

30. **How many triangles are there in the figure given below?**

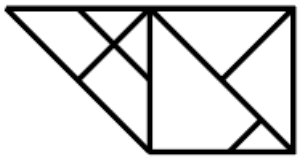

A 10

B 13

C 12

D 11

Answer: D

31. **Select the option that is related to the third word in the same way as the second word is related to the first word.**
France : Euro : : Myanmar : ?

A Ringgit

B Yen

C Euro

D Kyat

Answer: D

32. **Two different positions of the same dice are shown, the six faces of which are numbered from 1 to 6. Select the number that will be on the face opposite to the one having '5'.**

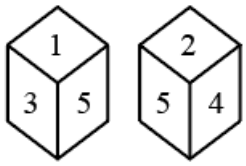

A 6

B 1

C 3

D 4

Answer: A

SSC Exam Update Videos & Free Study Material (YouTube Channel)

33. **Select the correct option that indicates the arrangement of the following words in a logical and meaningful order.**
1. Restaurant
2. Eating
3. Cooking
4. Order food
5. Serve food

A 1, 2, 3, 5, 4

Downloaded from cracku.in

B 1, 4, 3, 5, 2

C 4, 5, 3, 2, 1

D 1, 3, 4, 2, 5

Answer: B

34. **In a code language, if VISION is written as 176, then how will SEEING be written in the same language?**

A 153

B 118

C 148

D 140

Answer: B

35. **Four words have been given, out of which three are alike in some manner and one is different. Select the word that is different.**

A Amicability

B Dislike

C Consensus

D Rapport

Answer: B

Latest Job Updates on Telegram - Join here

36. **Select the combination of letters that when sequentially placed in the blanks of the given series will complete the series.**
_ _ c f b _ c _ b d _ f

A b c f d c

B b d d f c

C d c d f b

D f d c b c

Answer: B

37. **Select the number from among the given options that can replace the question mark (?) in the following series.**
33, 34, 30, 39, 23, 48, 12, ?

A 14

B 16

C 41

D 61

Answer: D

Downloaded from cracku.in

38. **Select the word-pair in which the two words are related in the same way as are the two words in the following word-pair.**
Litre : Millilitre

A Luminance : Tesla

B Kilogram : Gram

C Metre : Distance

D Inch : Height

Answer: B

Join SSC Daily Quiz Telegram Group

39. **Indicating a man in the photo rashmi told that he is my son's wife's husband's father. How that man is related to rashmi?**

A cousin brother

B bother in law

C husband

D brother

Answer: C

40. **In a certain code language, THICK is written as FELHW. How will RAISE be written in that language?**

A XFHBJ

B DBLOV

C DLBOV

D XHFUV

Answer: B

41. **Select the correct combination of mathematical signs that can sequentially replace the * signs and balance the given equation.**
25 * 48 * 6 * 12 * 2 = 41

A $\div, \times, +, -$

B $-, \div, +, \times$

C $-, \times, +, \div$

D $+, \div, -, \times$

Answer: B

42. **Select the option that is related to the fourth number in the same way as the first number is related to the second number and the fifth number is related to the sixth number.**
19 : 362 : : ? : 442 : : 17 : 290

A 20

Downloaded from cracku.in

B 21

C 22

D 18

Answer: B

43. **In the Venn Diagram given below, if 'Square' represents "Doctors', 'Triangle' represents 'Tennis Players' and 'Rectangle' represents 'Indians', Numbers represent the individuals in that category. How many doctors are Indians but NOT tennis players?**

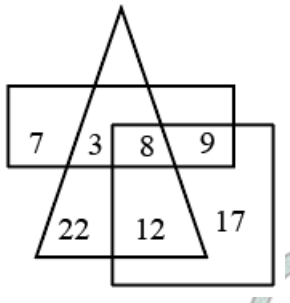

A 12

B 8

C 7

D 9

Answer: D

44. **Select the option in which the numbers share the same relationship as that shared by the numbers in the given set.**
(12, 18, 225)

A (21, 10, 324)

B (25, 15, 400)

C (13, 17, 140)

D (23, 13, 272)

Answer: B

SSC CHSL Free Mock Test

45. **Three of the following four letter-cluster pairs are alike in a certain way and one is different. Select the odd one.**

A PORT : TROP

B MODE : EDOM

C LIMB : BMIL

D FIST : IFTS

Answer: D

46. **Select the option that is related to the third term in the same way as the second term is related to the first term.**
SEVERAL : MZSDWDT : : HEADING : ?

Downloaded from cracku.in

A HMICBDJ

B HMJCBDI

C JDBCIMH

D IDBCJMH

Answer: B

47. **A total of 1012 candies are to be distributed among Virat, Ketan and Rohan in the ratio of 6 : 9 : 8, respectively. How many candies will Rohan get?**

A 396

B 352

C 450

D 264

Answer: B

SSC CHSL Prevoius Papers (DOWNLOAD PDF)

48. **A sheet of paper is folded in a particular manner and several punches are made. When unfolded, the paper looks like the given figure. Select the option that follows the manner in which the paper is folded and punched.**

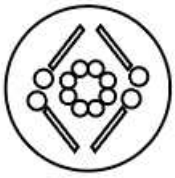

A

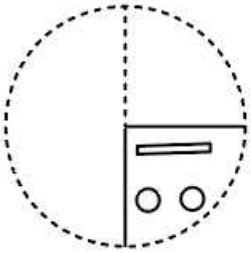

B

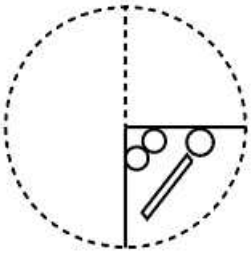

C

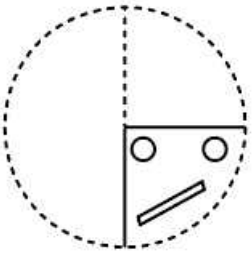

Downloaded from cracku.in

D 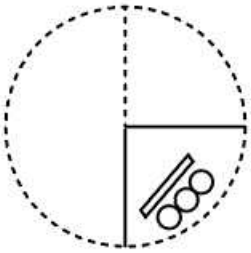

Answer: B

49. **Read the given statements and conclusions carefully. Assuming that the information given in the statements is true, even if it appears to be at variance with commonly known facts, decide which of the given conclusions logically follow(s) from the statements.**
Statements:
Some planets are stars.
All stars are satellites.
Conclusions:
I. All satellites are stars.
II. Some satellites are planets.

A Both conclusions I and II follow.

B Neither conclusion I nor II follows

C Only conclusion II follows.

D Only conclusion I follows

Answer: C

50. **Study the given pattern carefully and select the number that can replace the question mark (?) in it.**

14	22	5
18	42	11
22	35	?

A 9

B 12

C 7

D 8

Answer: D

SSC CGL Previous Papers (DOWNLOAD PDF)

Quantitative Aptitude

51. **A sum of ₹11,236 is divided among A, B and C such that the ratio of the shares of A and is 3 : 5 and theratio of the shares of A and C is 4 : 7. The share of B is:**

A ₹3,392

B ₹2,544

C ₹4,452

Downloaded from cracku.in

D ₹4,240

Answer: D

SSC CGL Free Mock Test (Latest Pattern)

52. **A shopkeeper earns 17% profit by selling an article at 10% discount on its markedprice. If its cost price is ₹480, then the marked price (in ₹)of the article is:**

A 640

B 624

C 636

D 600

Answer: B

53. **$\triangle PQR$ is inscribed in a circle. The bisector of $\angle P$ cuts QR at S and the circle at T. If PR = 5 cm, PS = 6 cm and ST = 4 cm, then the length (in cm) of PQ is:**

A 13

B 12

C 10

D 15

Answer: B

54. **The average weight of some students in a group is 58 kg. If 8 students of average weight 54 kg leave the group, and 3 students weighing 53.6 kg, 54 kg and 57.4 kg join the group,then the average weight of the remaining students in the group will increase by 575 g. The number of students, initially, in the group is:**

A 40

B 45

C 35

D 50

Answer: B

SSC CHSL Important Questions and Answers (Download PDF)

55. **A man buys goods for ₹8,000. Hesells 30% of those goodsat a profit of 12% and 40% of the remaining goods at a profit of 25%. At what profit percentage should he sell the remaining goods to gain 30% in the entire transaction (correct to one decimal place)?**

A 42.6%

B 46.2%

C 48.4%

D 31.6%

Downloaded from cracku.in

Answer: B

56. If $x + \frac{1}{x} = \frac{1}{\sqrt{7}}$, then what is the value of $(x^2 + 1) \div \left[x^4 + \left(\frac{1}{x^2}\right)\right]$?

A $2\sqrt{7}$

B $3\sqrt{7}$

C $\frac{1}{2}$

D $\frac{1}{4}$

Answer: D

57. ABCD is a cyclic quadrilateral whose diagonals intersect at P. If $\angle DBC = 72^\circ$ and $\angle BAC = 42^\circ$, then the measure of $\angle BCD$(in degrees) is:

A 66

B 65

C 60

D 57

Answer: A

SSC CHSL Study Material

58. Study the given graph and answer the question that follows.

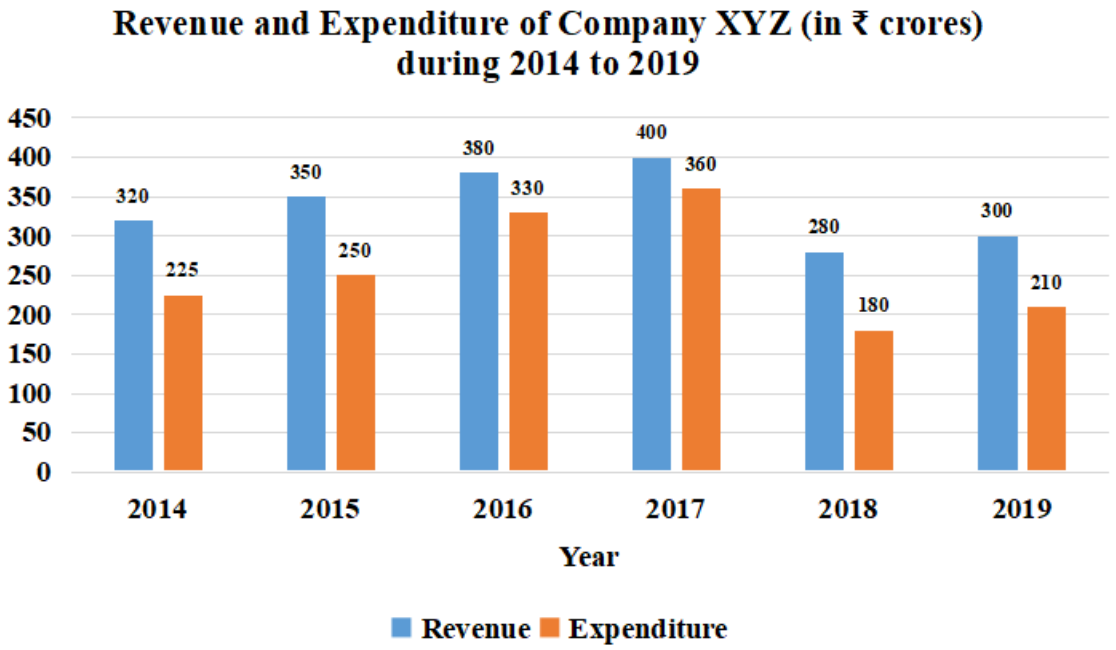

What is the ratio ofthe total revenue of the company in 2015 and 2018 to the total expenditure in 2017 and 2018?

A 9 : 10

B 6 : 5

C 7 : 6

Downloaded from cracku.in

D 5 : 4

Answer: C

59. **study the following pie chart where the distribution of five products (A, B, C, D and E) sold by a company in year 2019 is given and answer the following questions.**

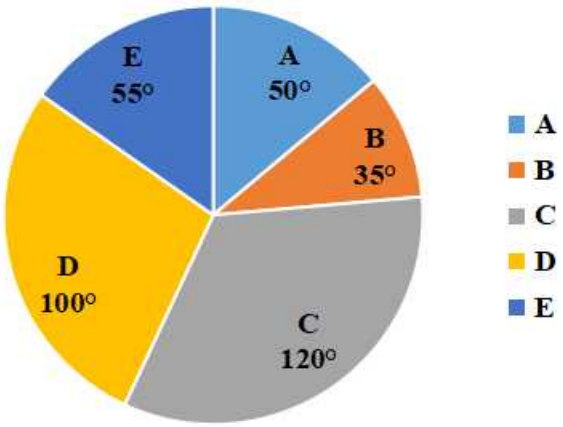

If in the year 2019 the number of units of product C sold is 2100 and in the year 2020 the number of units of the same product sold is 28% more than the year 2019, then find out the number of units sold by the company in 2020

A 8576

B 7428

C 6300

D 8064

Answer: D

60. **The price of an article increases by 5% every year. If the difference between its price at the end of the second and the third year is ₹52.50, then what will be its price at the end of the first year?**

A ₹1,000

B ₹950

C ₹840

D ₹900

Answer: A

SSC CHSL Free App

61. **The value of** $6 \times 3 \div 8 of 6 - 6 \div 4 \times (5 - 7) + 5 - 3 \times 4 \div 6 of 3$ **is:**

A $7\frac{17}{24}$

B $4\frac{1}{3}$

C $5\frac{5}{8}$

D $5\frac{11}{24}$

Answer: A

Downloaded from cracku.in

62. A sum of ₹x amounts to ₹9,246 in 4 years and to ₹11,298.75 in $7\frac{1}{2}$ years, at y% p.a. simple interest. The values of x and y are, respectively:

A 6900 and 8.5

B 6800 and 8.5

C 6500 and 8

D 7200 and 7.5

Answer: A

63. Study the given graph and answer the question that follows.

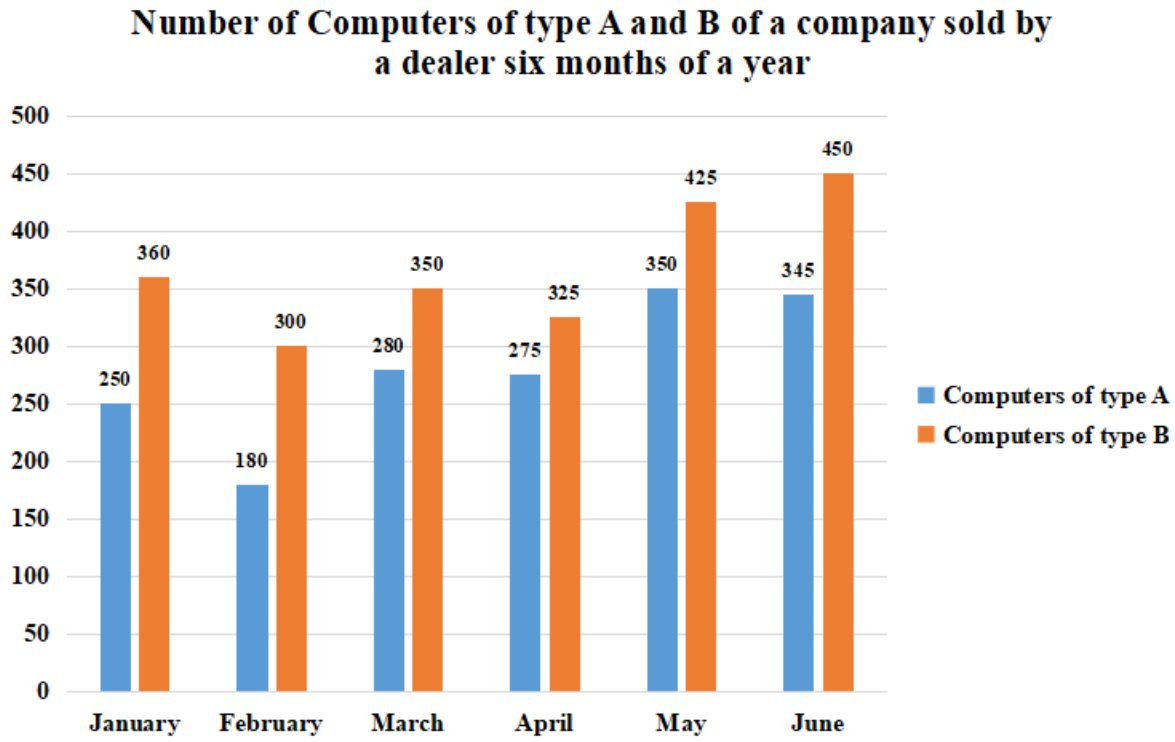

The total number of computers of type A sold in January and Mayis what percentage less than the total number of computers of type B sold from March to May? (correct to one decimal place)

A 40.9

B 54.5

C 83.3

D 45.5

Answer: D

Daily Free SSC Practice Set

64. $\frac{(1+\cos\theta)(\operatorname{cosec}\theta-\cot\theta)\sec\theta}{\sin\theta(1-\sin\theta)(\sec\theta+\tan\theta)}=?$

A $\sec^2\theta$

B $\sin^2\theta$

Downloaded from cracku.in

C $\cos^2\theta$

D $\operatorname{cosec}^2\theta$

Answer: A

65. **In $\triangle ABC, DEF \parallel BC$, where D and E are points on the sides AB and AC, respectively. If AD = 2cm,BD = 5.2 cm,AC = 9 cm and AE = x cm, then whatis the value of x ?**

A 3.5

B 4

C 3

D 2.5

Answer: D

66. **If $\sin\theta(2\sin\theta+3)=2, 0^\circ<\theta<90^\circ$, then what is the value of $(\sec^2\theta+\cot^2\theta-\cos^2\theta)$?**

A $\frac{13}{3}$

B $\frac{31}{12}$

C $\frac{7}{2}$

D $\frac{43}{12}$

Answer: D

Free SSC Study Material (18,000 Solved Questions)

67. **The area of a triangular field whose sides are 65 m. 72 m. and 97 m is equalto the area of a rectangular park whose sides are in the ratio of 5 ; 13. Whatis the perimeter (in m) of the rectangular park?**

A 108

B 180

C 216

D 144

Answer: C

68. **A, B and C together can complete a work in x , 30 and 45 days, respectively. B and C worked together for 6 days. The remaining work was completed by A alone in 12 days. The value of x is:**

A 18

B 20

C 24

D 15

Answer: A

Downloaded from cracku.in

69. If $x+y+z=3, x^2+y^2+z^2=45$ and $x^3+y^3+z^3=69$, then what is the value of xyz ?

A -40

B 40

C -30

D 30

Answer: A

1500+ Very Important Free SSC Solved Questions

70. In $\triangle ABC, D$ and E are points on sides AB and BC, respectively, such that BD: DA = 1: 2 and CE: EB = 1: 4. If DC and AE intersect at F, then FD: FC is equal to:

A 3 : 2

B 5 : 2

C 8 : 3

D 4 : 1

Answer: C

71. The six-digit number 537xy 5 is divisible by 125. How many such six-digit numbers are there?

A 4

B 2

C 3

D 5

Answer: A

72. If $4\sqrt{3}x^2+5x-2\sqrt{3}=(Ax+2)(Bx+C)$, then what is the value of $(A+B+C)$?(A > 0)

A 4

B $4+\sqrt{3}$

C $2\sqrt{3}$

D $4-\sqrt{3}$

Answer: A

SSC Exam Update Videos & Free Study Material (YouTube Channel)

Downloaded from cracku.in

73. **The given bar-graph shows the number of boys and girls in classes A, B, C and D in a school, and the number of teachers allotted to each class.**

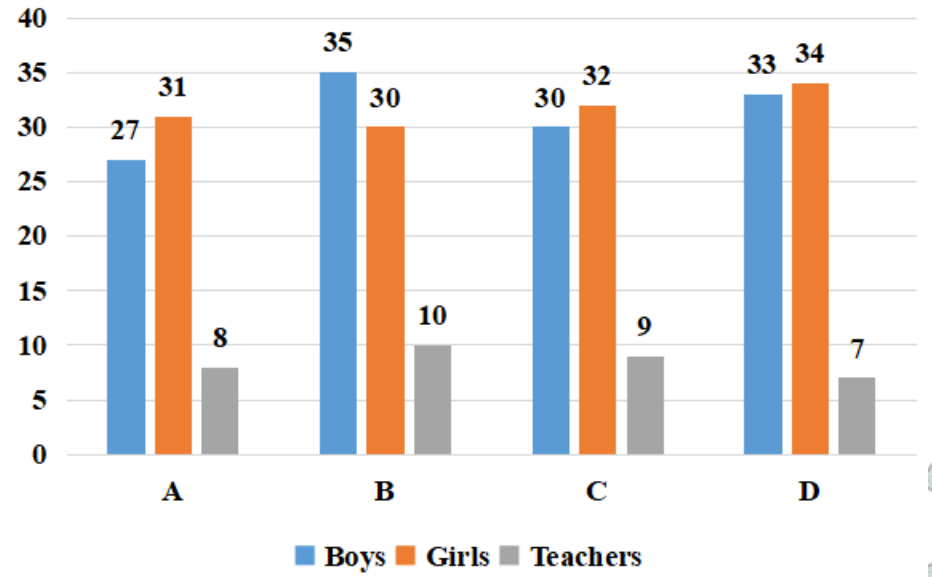

Which class has the least percentage of girls?

A B

B D

C C

D A

Answer: A

74. **Two cars X and Y start running towards each other from two places 216 km apart. The ratio of the speeds of X and Y is 5: 7 and the speed of X is 60 km/h. After how many minutes will X and Y meet each other?**

A 75

B 72

C 90

D 80

Answer: C

75. **If** $\sin\theta = \frac{11}{15}$**, then the value of** $(\sec\theta - \tan\theta)$ **is:**

A $\frac{2\sqrt{26}}{13}$

B $\frac{\sqrt{26}}{13}$

C $\frac{4}{\sqrt{26}}$

D $\frac{1}{\sqrt{26}}$

Answer: B

Downloaded from cracku.in

Latest Job Updates on Telegram - Join here

General Awareness

76. **In which of the following states/union territories is India's highest Meteorological Centre situated?**

A Assam

B Meghalaya

C Ladakh

D Jammu and Kashmir

Answer: C

Join SSC Daily Quiz Telegram Group

77. **Who among the following is the brand ambassador of Entri, a local learning app for jobs?**

A Mary Kom

B Rohit Sharma

C Robin Uthappa

D Sania Mirza

Answer: C

78. **The polity of a country is designed according to its _____ and any change to the polity is possible only when an amendment is made.**

A Constitution

B People

C Government

D Preamble

Answer: A

79. **Which of the following is the only state in India that produces diamonds?**

A Andhra Pradesh

B Kolkata

C Uttarakhand

D Madhya Pradesh

Answer: D

80. **Who among the following is the Regional Ambassador for India for UNEP (United Nations Environment Programme) as of December 2020?**

Downloaded from cracku.in

A Virat Kohli

B Akshay Kumar

C Khushi Chindaliya

D Dia Mirza

Answer: C

81. **When was the Jal Jeewan Mission launched by the Prime Minister, with the goal of 'Har Ghar Jal'?**

A 2015

B 2019

C 2014

D 2020

Answer: B

82. **New Development Bank (NDB) is a multilateral development bank established in 2014. How many countries are members of NDB?**

A 25

B 12

C 9

D 5

Answer: D

SSC CHSL Free Mock Test

83. **In which of the following years was the Supreme Court set up in Calcutta by the East India Company?**

A 1734

B 1850

C 1890

D 1773

Answer: D

84. **With which of the following banks has the Government of India signed a $500 million project to build safe and green national highway corridors in Rajasthan, Himachal Pradesh, Andhra Pradesh and Uttar Pradesh?**

A IMF

B ADB

C AIIB

D World Bank

Downloaded from cracku.in

Answer: D

85. **Who has been nominated as a member on the GAVI Board by the Global Alliance for Vaccines and Immunisation in December 2020?**

A Amit Shah

B Narendra Modi

C Harsh Vardhan

D Smriti Irani

Answer: C

SSC CHSL Prevoius Papers (DOWNLOAD PDF)

86. **In which of the following cities was the International Gita Mahotsav held in November - December 2020?**

A Mumbai

B Amritsar

C Kurukshetra

D Patna

Answer: C

87. **In which of the following states is the Losoong festival celebrated?**

A Sikkim

B Andhra Pradesh

C Karnataka

D Himachal Pradesh

Answer: A

88. **BWF (Badminton World Federation) has imposed a 5-year ban on shuttler Nikita Khakimov on the charges of betting, wagering and irregular match results. He represents which of the following countries?**

A Japan

B Canada

C Portugal

D Russia

Answer: D

SSC CGL Previous Papers (DOWNLOAD PDF)

89. **Infrared optical _____ can be used for measuring and monitoring temperatures and hot spots of jet engine rotor blades.**

Downloaded from cracku.in

A ammeter

B hygrometer

C pyrometer

D machmeter

Answer: C

90. **Which of the following is the full form of ASCII?**

A American Standard Code for Information Interchange

B Asian Standard Code for Information Interchange

C Analytical Scientific Code for Information Interchange

D Analytical Standard Code for Intermitted Information

Answer: A

91. **Linganamakki Dam is built across which of the following rivers?**

A Sharavathi

B Yamuna

C Krishna

D Tunga Bhadra

Answer: A

SSC CGL Free Mock Test (Latest Pattern)

92. **Trachoma is a preventable disease that results from poor hygiene and sanitation. Which of the following body parts does it affect?**

A Eye

B Ear

C Stomach

D Heart

Answer: A

93. **Kolhapur city is located on the banks of which of the following rivers?**

A Panchganga

B Sarau

C Chambal

D Misu

Answer: A

Downloaded from cracku.in

94. **Who among the following cricketers has won the 'Sir Garfield Sobers Award' for the ICC Male Cricketer of the Decade and ICC Men's ODI Cricketer of the Decade Award in December 2020?**

A Steve Smith

B Joe Root

C Virat Kohli

D Mahendra Singh Dhoni

Answer: C

SSC CHSL Important Questions and Answers (Download PDF)

95. **Which of the following state's government has launched the flagship programme 'Pedalandariki Illu' (housing for the poor) scheme in December 2020?**

A Karnataka

B Tamil Nadu

C Kerala

D Andhra Pradesh

Answer: D

96. **In which of the following states will the 4th edition of Khelo India Youth Games be held?**

A Haryana

B Chhattisgarh

C Bihar

D Assam

Answer: A

97. **An/A _____ is a finite set of instructions which, when followed, accomplish a particular task.**

A array

B algorithm

C data

D node

Answer: B

SSC CHSL Study Material

98. **Who among the following rulers inscribed his messages to his subjects and officials on stone surfaces?**

A Ashoka

Downloaded from cracku.in

B Chandragupta I

C Bindusara

D Chandragupta Maurya

Answer: A

99. **In which of the following years did the Supreme Court of India come into existence after Independence?**

A 1955

B 1948

C 1950

D 1952

Answer: C

100. **Who among the following has assumed the charge of Director General of the Armed Forces Medical Services on 1 January 2021?**

A JG Roach

B MS Batola

C AK Hooda

D Rajat Datta

Answer: D

SSC CHSL Free App

SSC CHSL Free Mock Test

SSC CHSL Prevoius Papers (DOWNLOAD PDF)

SSC CGL Previous Papers (DOWNLOAD PDF)

SSC CGL Free Mock Test (Latest Pattern)

SSC CHSL Important Questions and Answers (Download PDF)

SSC CHSL Study Material

SSC CHSL Free App

Daily Free SSC Practice Set

Downloaded from cracku.in

Free SSC Study Material (18,000 Solved Questions)

1500+ Very Important Free SSC Solved Questions

SSC Exam Update Videos & Free Study Material (YouTube Channel)

Latest Job Updates on Telegram - Join here

Join SSC Daily Quiz Telegram Group

Downloaded from cracku.in